CONFRONTO TRA FRAZIONI

Colora come indicato da ogni frazione e metti i segni < oppure >

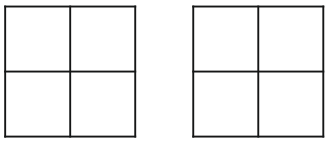

$\frac{3}{4}$ ☐ $\frac{2}{4}$

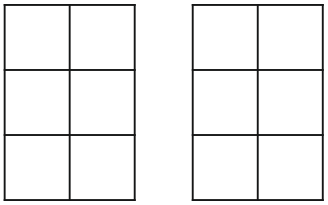

$\frac{4}{6}$ ☐ $\frac{2}{6}$

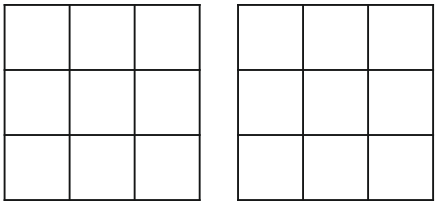

$\frac{6}{9}$ ☐ $\frac{5}{9}$

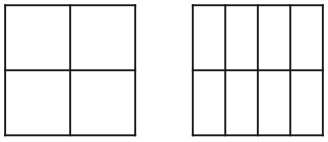

$\frac{1}{4}$ ☐ $\frac{1}{8}$

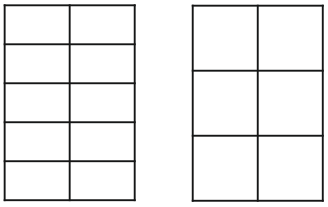

$\frac{5}{10}$ ☐ $\frac{5}{6}$

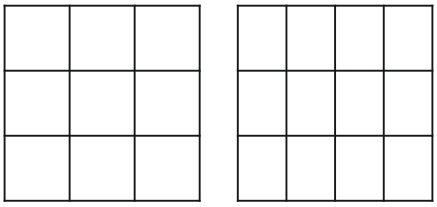

$\frac{4}{9}$ ☐ $\frac{4}{12}$

Metti i segni < > =

$\frac{2}{5}$ ☐ $\frac{4}{5}$ $\frac{6}{11}$ ☐ $\frac{2}{11}$ $\frac{3}{8}$ ☐ $\frac{1}{8}$ $\frac{5}{9}$ ☐ $\frac{9}{9}$ $\frac{3}{4}$ ☐ $\frac{1}{4}$

$\frac{4}{7}$ ☐ $\frac{4}{5}$ $\frac{1}{12}$ ☐ $\frac{1}{10}$ $\frac{5}{6}$ ☐ $\frac{5}{8}$ $\frac{2}{2}$ ☐ $\frac{2}{7}$ $\frac{3}{9}$ ☐ $\frac{3}{4}$

$\frac{1}{2}$ ☐ $\frac{2}{3}$ $\frac{4}{7}$ ☐ $\frac{3}{5}$ $\frac{6}{9}$ ☐ $\frac{2}{3}$ $\frac{1}{2}$ ☐ $\frac{6}{12}$ $\frac{8}{9}$ ☐ $\frac{10}{11}$

Metti in ordine crescente
le frazioni seguenti

$\frac{2}{4}$	$\frac{2}{8}$	$\frac{2}{5}$	$\frac{2}{7}$	$\frac{2}{10}$	$\frac{2}{12}$	$\frac{2}{6}$	$\frac{2}{3}$
.....	.....	.....	.....	.....	.....	.....	.....

Metti in ordine decrescente
le frazioni seguenti

$\frac{3}{5}$	$\frac{3}{4}$	$\frac{3}{9}$	$\frac{3}{10}$	$\frac{3}{7}$	$\frac{3}{11}$	$\frac{3}{3}$	$\frac{3}{12}$
.....	.....	.....	.....	.....	.....	.....	.....