MAGGIORE O MINORE?

7		12	14		19	9		13
15		10	8		16	11		6
13		18	19		11	17		16
5		15	20		10	18		19

COMPLETA LE SEQUENZE DI OPERAZIONI

13	+ 1 →		+ 2 →		+ 1 →		+ 2 →		+ 1 →	
17	- 1 →		- 2 →		- 1 →		- 2 →		- 1 →	
18	+ 2 →		- 3 →		+ 0 →		- 7 →		+ 5 →	
11	- 1 →		+ 8 →		- 2 →		+ 1 →		- 7 →	

ORDINA I NUMERI DAL MAGGIORE AL MINORE.

18	12	3	9	20	15	6	17
A	A	E	L	F	F	L	R







20							
F							